Date _____

# 6.4 Parallel and Perpendicular Lines

Graphed below are some PARALLEL lines:

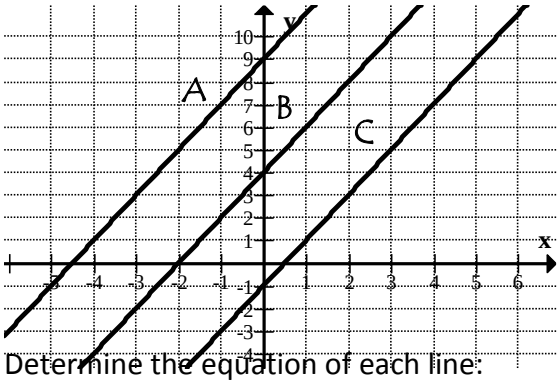


Determine the equation of each line:

A B C

What do you notice about parallel lines???

Graphed below are some sets of PERPENDICULAR lines:

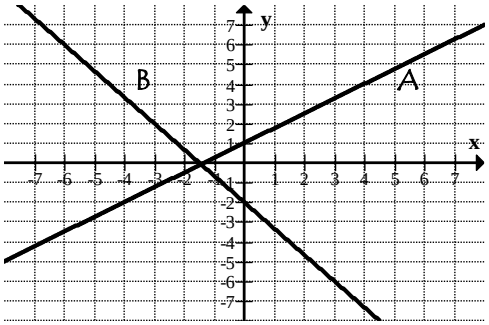


Determine the equation of each line:

A B

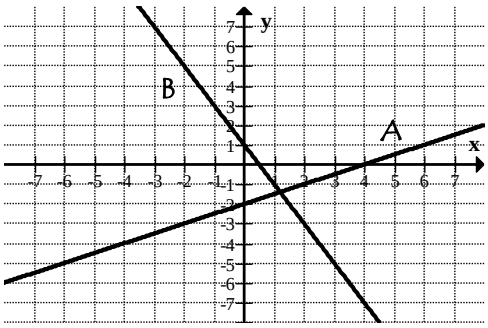


Determine the equation of each line:

A B

What do you notice about perpendicular lines???

**CONCLUSION**

PARALLEL LINES

PERPENDICULAR LINES

HW. p. 328 #3-9